Vendredi 15 mai

Prénom : _____ Date: _____

CALCULS : la table de 4

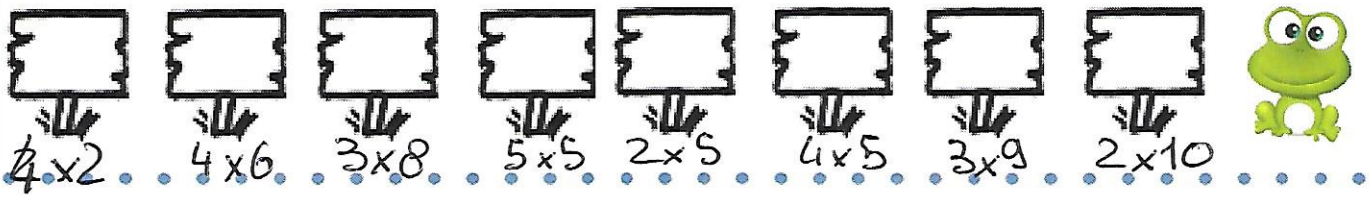

1 Ecris la multiplication correspondante et calcule:



__ x __ = __

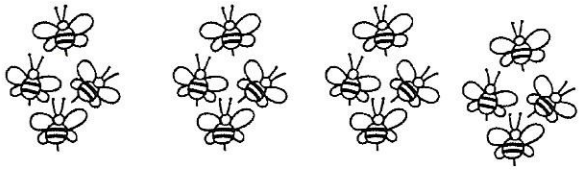

__ x __ = __



__ x __ = __



__ x __ = __

2 Calcule :

4 x 5 = __	4 x 1 = __	4 x 3 = __
4 x 4 = __	4 x 0 = __	4 x 7 = __
4 x 8 = __	4 x 9 = __	4 x 10 = __
4 x 6 = __	4 x 2 = __	4 x 20 = __

Problème :

6 enfants sont dans un verger. Ils ont le droit de cueillir 4 kg de pêches.
Combien de kilogrammes vont-ils cueillir?

dessin ou calcul :

phrase réponse :